Transformationen erkennen 1

Welche Transformationen werden auf den rechts in einer Raumecke platzierten Körper ausgeübt?

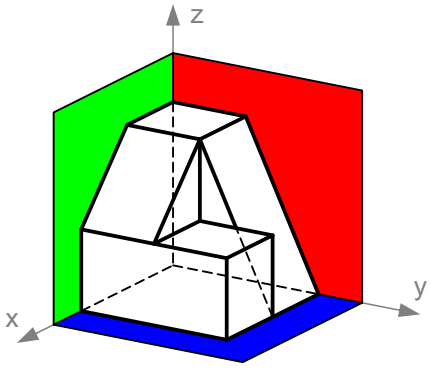

A

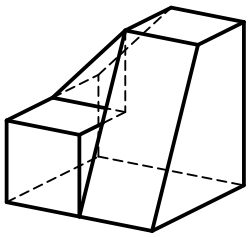

B

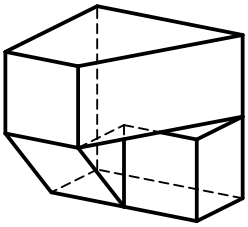

C

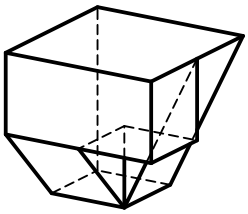

D

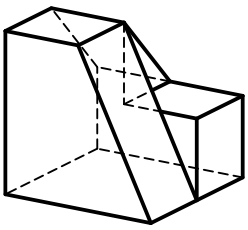

E

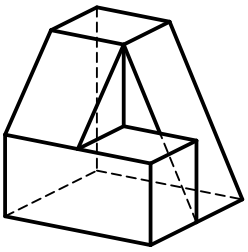

Setze den richtigen Buchstaben ein!

Schiebung	Drehung um			Spiegelung an		
	x-Achse	y-Achse	z-Achse	xy-Ebene	yz-Ebene	zx-Ebene

Transformationen erkennen 2

Welche Transformationen werden auf den rechts in einer Raumecke platzierten Körper ausgeübt?

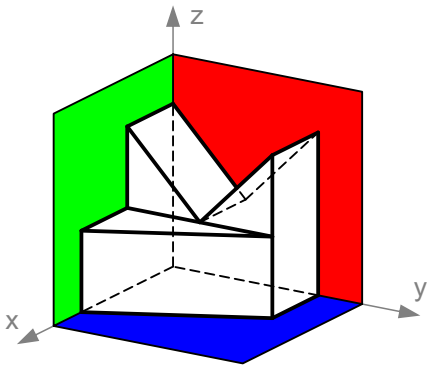

A

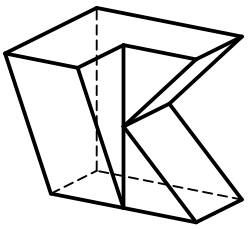

B

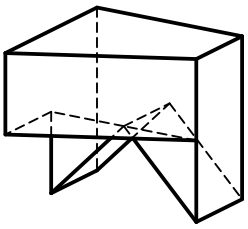

C

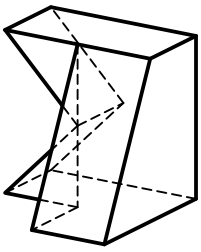

D

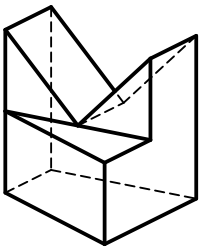

E

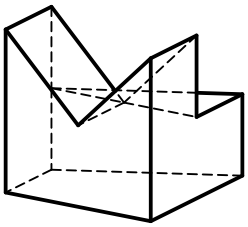

Setze den richtigen Buchstaben ein!

Schiebung	Drehung um			Spiegelung an		
	x-Achse	y-Achse	z-Achse	xy-Ebene	yz-Ebene	zx-Ebene